Creación de relojes Nombre:

Dibuje la manecilla de las horas y los minutos en el reloj para que represente la hora mostrada.

1) 5:30

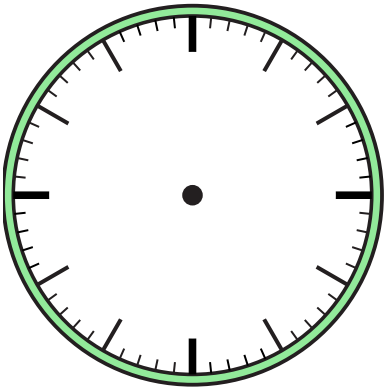

2) 6:30

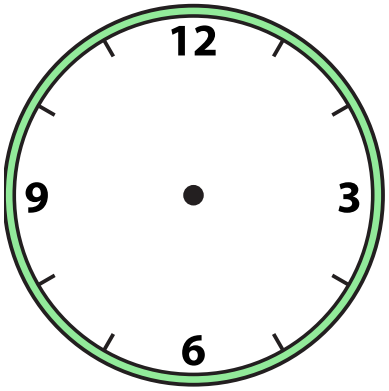

3) 11:00

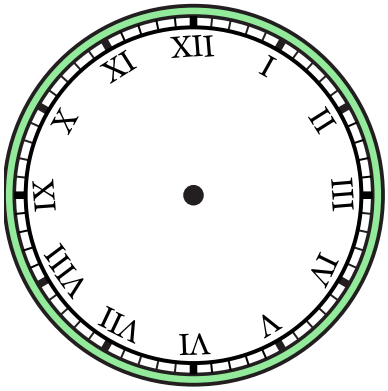

4) 1:00

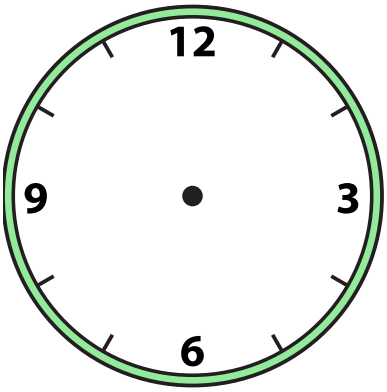

5) 6:00

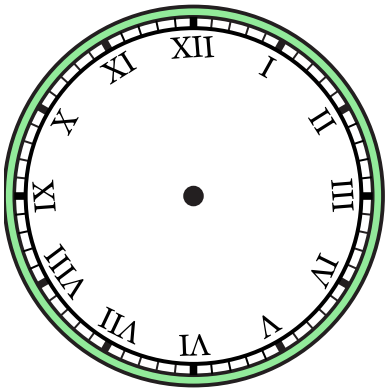

6) 8:30

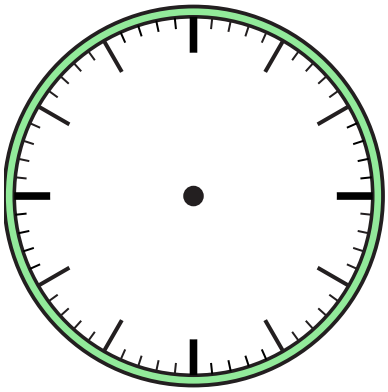

7) 12:30

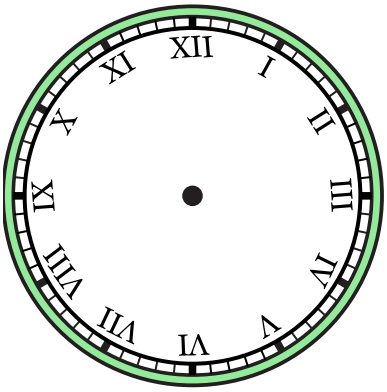

8) 12:00

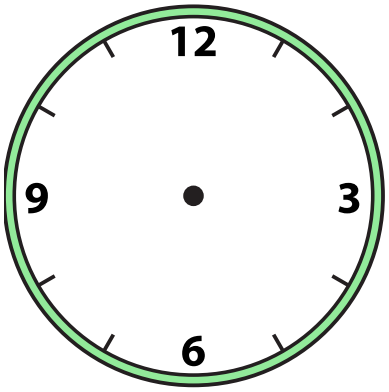

9) 10:00

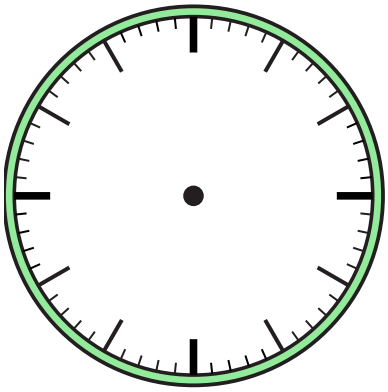

Creación de relojes

Nombre: **Clave De Respuestas**

Dibuje la manecilla de las horas y los minutos en el reloj para que represente la hora mostrada.

1) 5:30



2) 6:30



3) 11:00



4) 1:00



5) 6:00

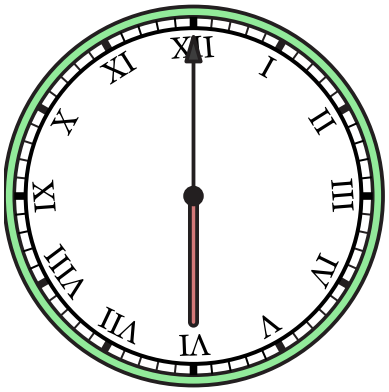

6) 8:30



7) 12:30

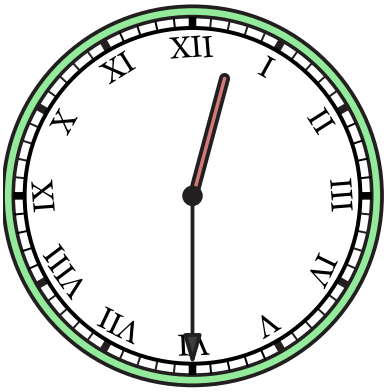

8) 12:00



9) 10:00



1-9	89	78	67	56	44	33	22	11	0