Dibuje la manecilla de las horas y los minutos en el reloj para que represente la hora mostrada.

1) 12:22

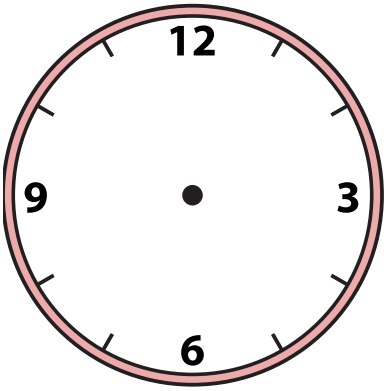

2) 6:44

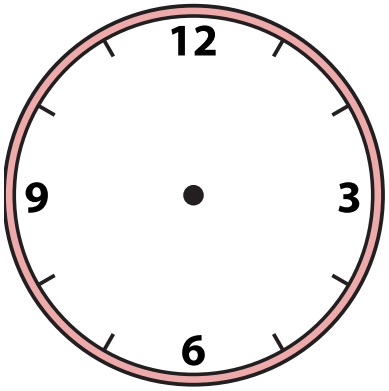

3) 7:18

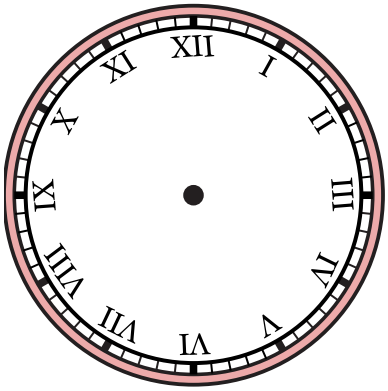

4) 8:51

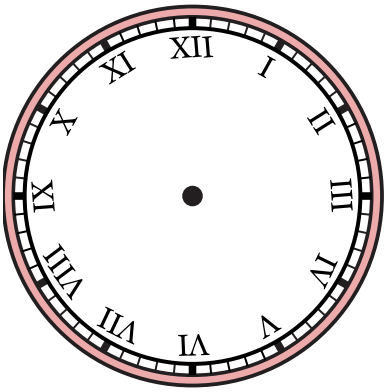

5) 2:09

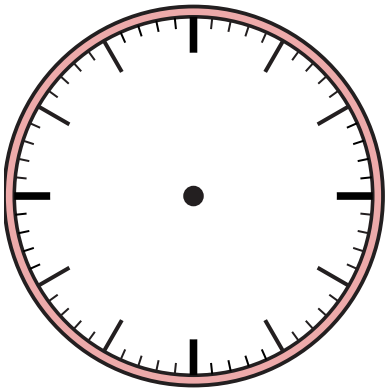

6) 2:03

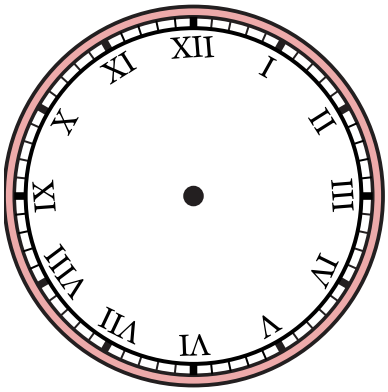

7) 12:29

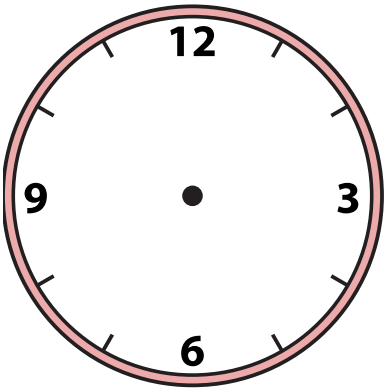

8) 2:35

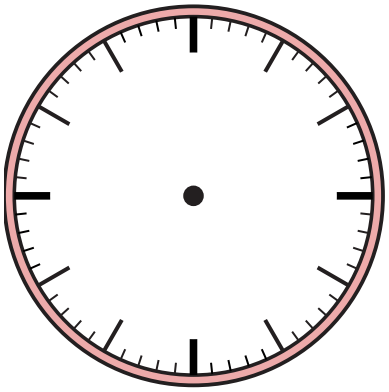

9) 9:31

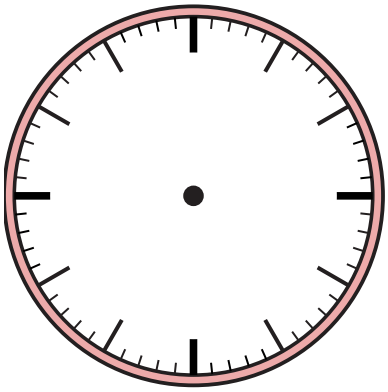

1-9	89	78	67	56	44	33	22	11	0

Dibuje la manecilla de las horas y los minutos en el reloj para que represente la hora mostrada.

1) 12:22



2) 6:44



3) 7:18

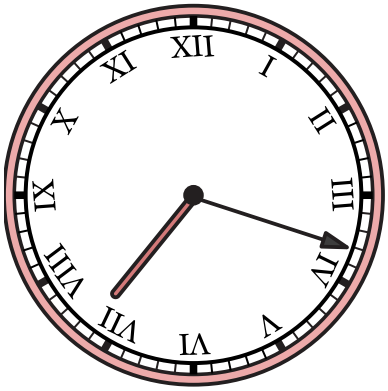

4) 8:51



5) 2:09

6) 2:03



7) 12:29



8) 2:35

9) 9:31



1-9	89	78	67	56	44	33	22	11	0