Encontrando el valor con bloque de Valor posicional Nombre:

Contar el número total de pequeños bloques.

1)
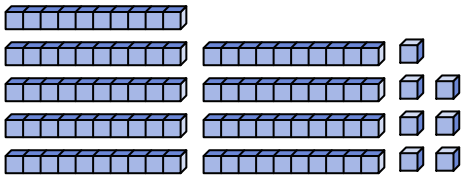

2)
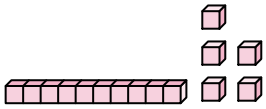

3)
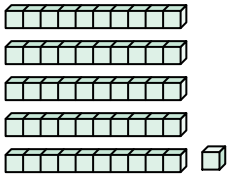

4)
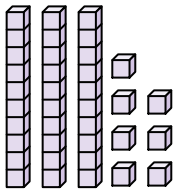

5)
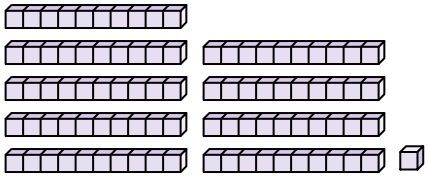

6)
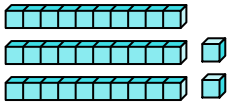

7)
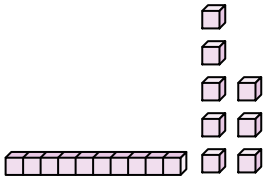

8)
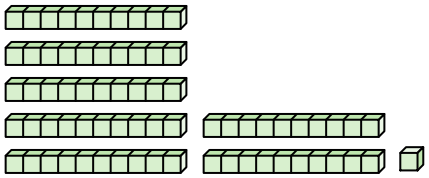

9)
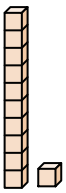

10)
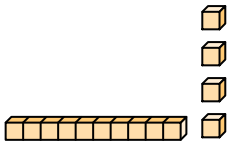

11)
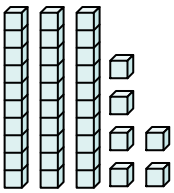

12)
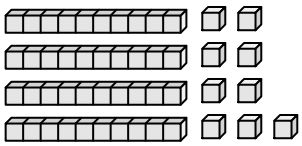

Respuestas

1. _____
2. _____
3. _____
4. _____
5. _____
6. _____
7. _____
8. _____
9. _____
10. _____
11. _____
12. _____

1-10	92	83	75	67	58	50	42	33	25	17
11-12	8	0								

Encontrando el valor con bloque de Valor posicional Nombre: **Clave De Respuestas**

Contar el número total de pequeños bloques.

1)
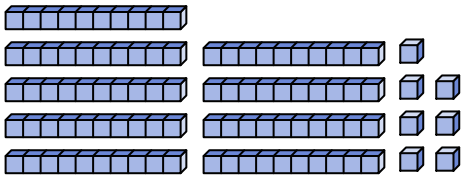

2)
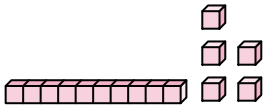

3)
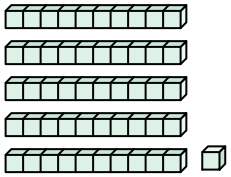

4)
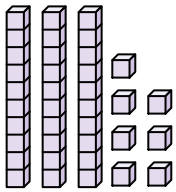

5)
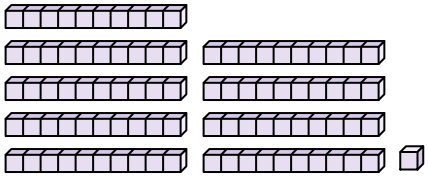

6)
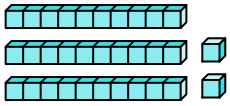

7)
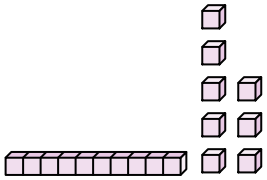

8)
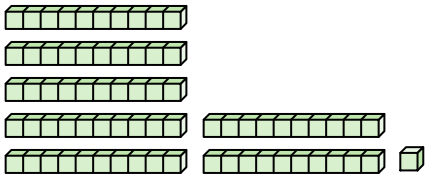

9)
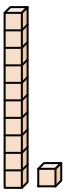

10)
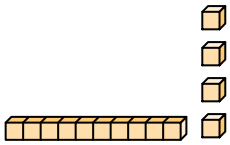

11)
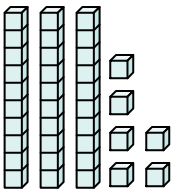

12)
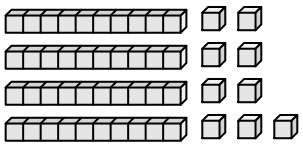

Respuestas

1. 97
2. 15
3. 51
4. 37
5. 91
6. 32
7. 18
8. 71
9. 11
10. 14
11. 36
12. 49

1-10	92	83	75	67	58	50	42	33	25	17
11-12	8	0								

Encontrando el valor con bloque de Valor posicional Nombre:

Contar el número total de pequeños bloques.

15	11	91	51	37
14	18	71	32	97

1)

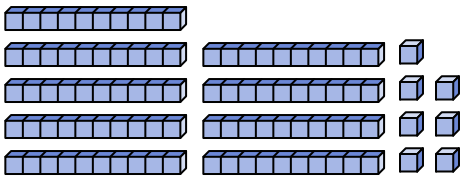

2)

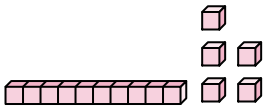

3)

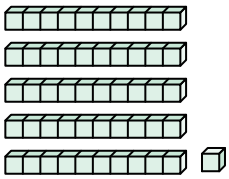

4)

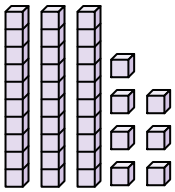

5)

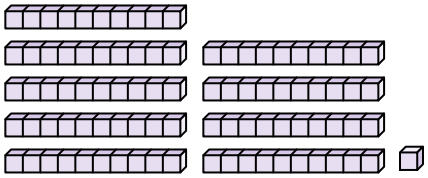

6)

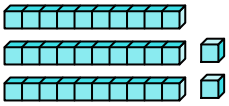

7)

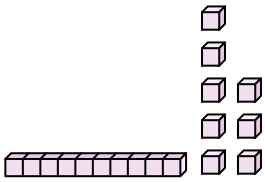

8)

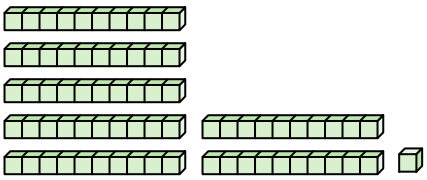

9)

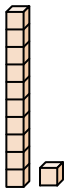

10)

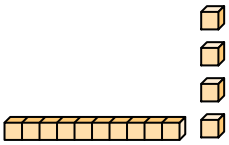

Respuestas

1. _____
2. _____
3. _____
4. _____
5. _____
6. _____
7. _____
8. _____
9. _____
10. _____

1-10	90	80	70	60	50	40	30	20	10	0