Determinación del valor con bloques

Nombre:

Encontrar el valor que cada conjunto de bloques representa.

1)

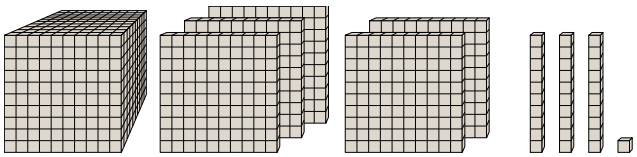

2)

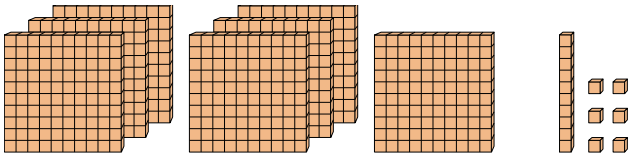

3)

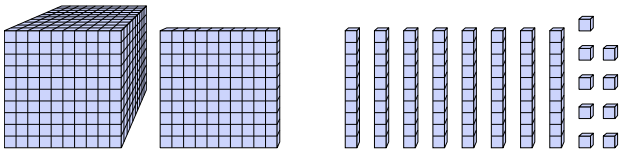

4)

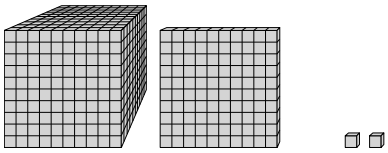

5)

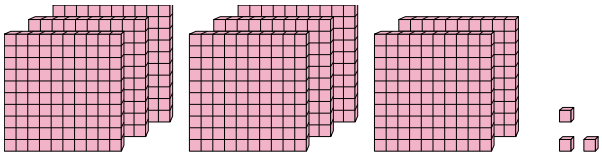

6)

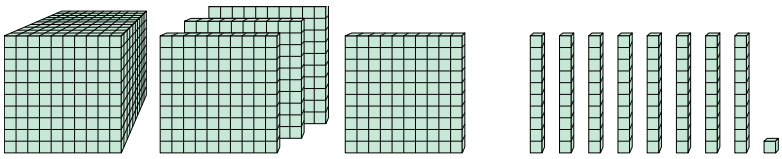

7)

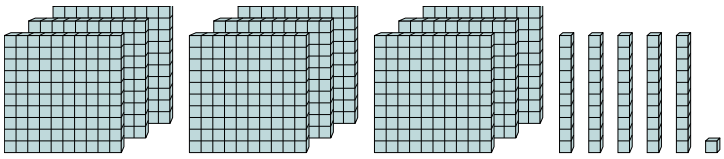

8)

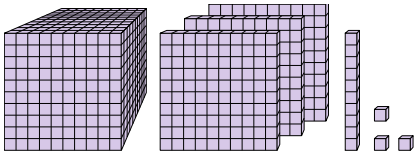

9)

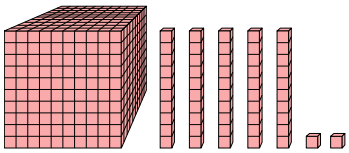

10)

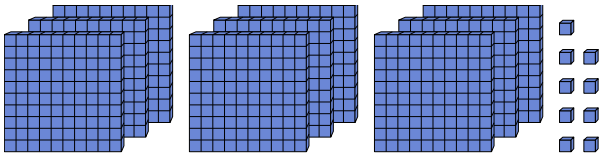

Respuestas

1. _____
2. _____
3. _____
4. _____
5. _____
6. _____
7. _____
8. _____
9. _____
10. _____

1-10	90	80	70	60	50	40	30	20	10	0

Encontrar el valor que cada conjunto de bloques representa.

1) 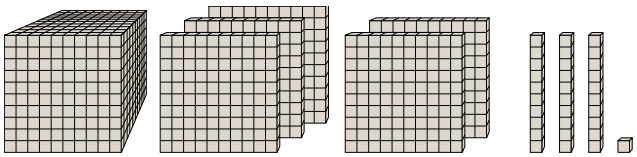

2) 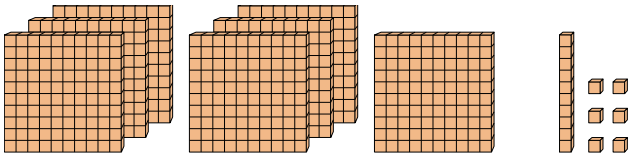

3) 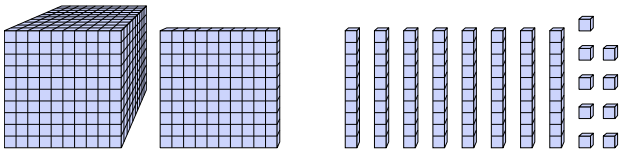

4) 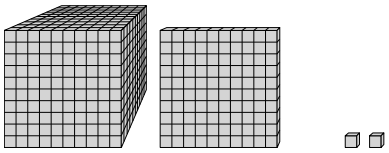

5) 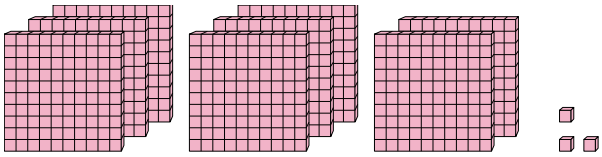

6) 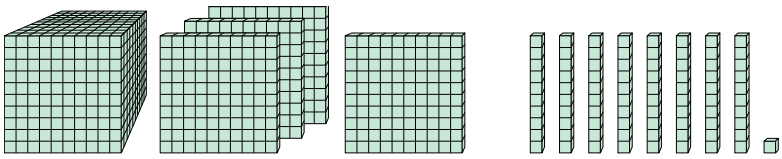

7) 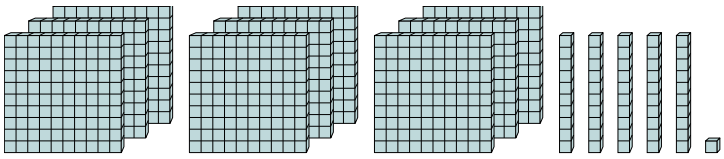

8) 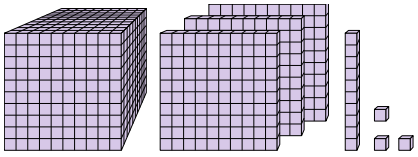

9) 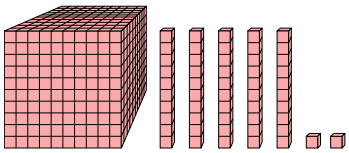

10) 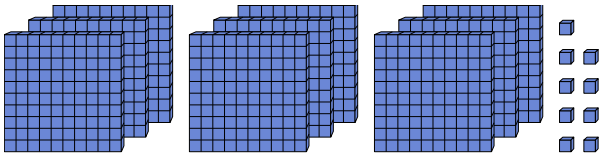

Respuestas

1. **1,531**
2. **716**
3. **1,189**
4. **1,102**
5. **803**
6. **1,481**
7. **951**
8. **1,313**
9. **1,052**
10. **909**

1-10	90	80	70	60	50	40	30	20	10	0